氏名〔　　〕

14 面積

／100点

（①各5点×10＝50点，②各10点×5＝50点）

① 次の図形の面積を求めなさい。ただし円周率は 3.14 とします。

□(1)　正方形

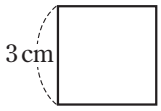

□(2)　長方形

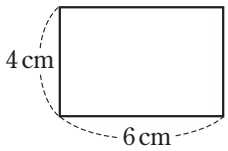

□(3)　平行四辺形

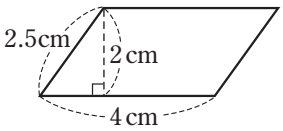

□(4)　平行四辺形

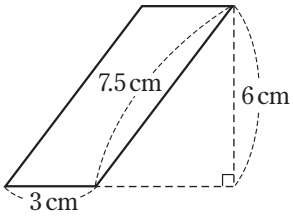

□(5)　三角形

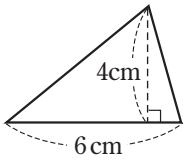

□(6)　三角形

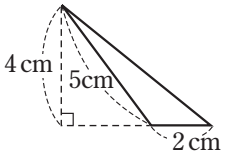

□(7)　二等辺三角形

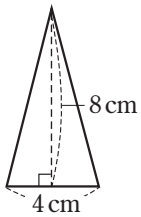

□(8)　直角三角形

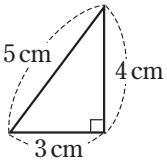

□(9)　円

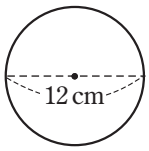

□(10)　円の一部

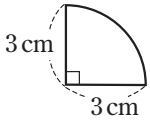

② 次の図形で色のぬった部分の面積を求めなさい。ただし円周率は 3.14 とします。

□(1)

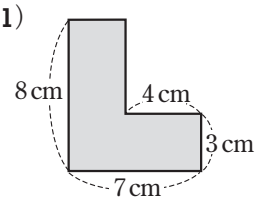

□(2)

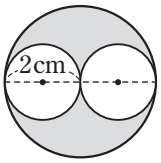

□(3)

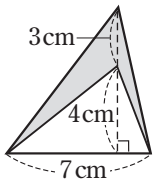

□(4)

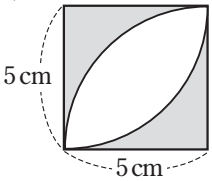
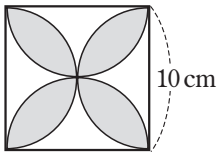
□(5)